MOTHER TERESA PUBLIC SCHOOL

HONGASANDRA , BANGALORE -560068

LESSON BASED STUDY MATERIAL / ASSESSMENT (LBA - 2026- 2027)

CLASS: 2 nd

SUBJECT : Mathematics

Ref : DEPARTMENT OF STATE RESEARCH & TRAINING CENTRE

INDEX

SN	Upload Date	Title	Approved on/ by	Remarks
07	07/11/2026	Rani's Gift		
08	07/11/2026	Grouping and Sharing		

CHAPTER -7
Rani's Gift

1. UNIT MEASUREMENT :

1. KILOGRAM = KG
2. GRAM = G
3. KILOMETER = KM
4. METRE = M
5. LENGTH = L

2 . DRAW TWO THINGS WHICH IS HEAVY WEIGHT :



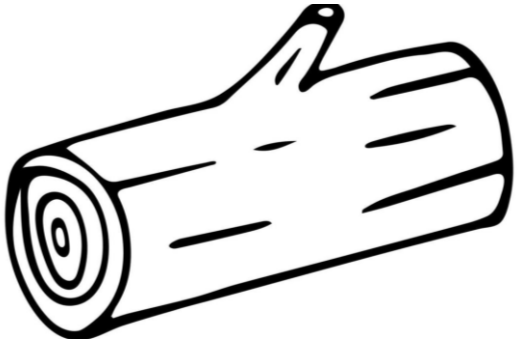

3 . DRAW TWO THINGS WHICH IS LIGHT WEIGHT :





4 . FILL IN THE BLANKS:

1. MUSKMELON IS HEAVIER THAN CARROT
2. CAPSICUM IS LIGHTER THAN **CAULIFLOWER**
3. **BRINJAL** IS HEAVIER THAN **CARROT**
4. **PUMPKIN** IS THE HEAVIEST OF ALL
5. **CHILLY** IS THE LIGHTEST OF ALL

5. ESTIMATED LENGTH AND ACTUAL LENGTH OF THE FOLLOWING OBJECT:

object	Estimated length	Actual length
1. 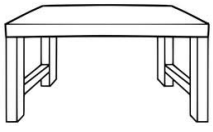	15	3
2. 	15	10

3. 	20	15

6. ANSWER THE FOLLOWING QUESTIONS:

1. How many mangoes will balance the watermelon?

Ans: 6 mangoes will balance the one watermelon

2. Two paper of bags of same size .One with sand and the other with dry leaves .Compare those and write which is heavy ? why?

Ans: The first bag [sand bag] is heavy

7. TICK THE OBJECT WHICH IS TALL.

1.

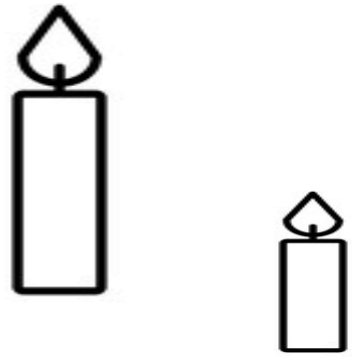

✔

2.

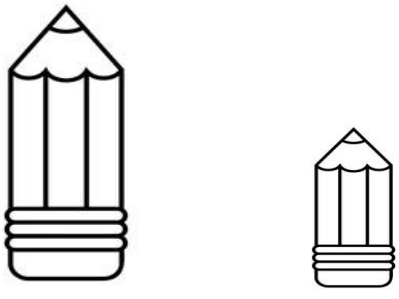

✔

3.

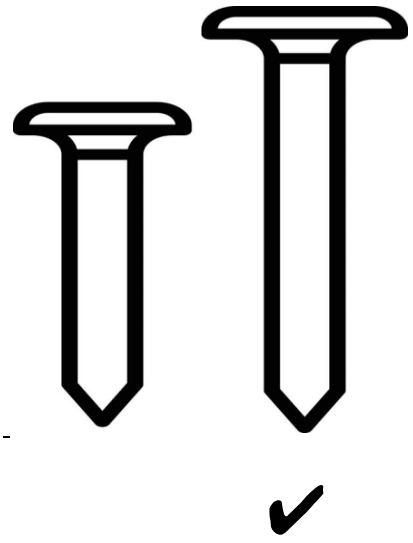

4.

Chapter-8

Grouping and Sharing

I. Fill in the Blanks

1. 2 + 2+ 2+ 2 is equal to 4___ times of 2.
2. 3 times of 2 is equal to 6.
3. 2 x 5 = 10.
4. 5 times is 5.
5. Number of soldiers standing in a row of 4 / 10 = 40
6. If 5 roses can be placed in a vase , it takes 5th vase to hold 25 roses.

II. Match the following :

1. 9 + 9+ 9	9 x3	27
2. 5+5+5+5	5 x 4	20
3. 10 +10+10 +10	10 x 4	40
4. 8+ 8+ 8	8 x 3	24
5. 7+ 7	7 x2	14

III. Answer the following .Word Problems.

1. Rita bought 6 Pencils for ₹ 4 each .How much money she gave to the shop keeper ?

Answer : Number of Pencils = 6

Cost of each pencil = 4

Cost of 6 pencils = 6 x 4 = 24

Rita gave money to Shopkeeper **= ₹ 24.**

2. There are 8 Packets of bindi 's . Each Packet has 5 bindi's.

How many bindi's are there in Total ?

Answer : Number of Packets = 8

Number of bindi's in each packet = 5

Total bindi's = 8 x 5 **= 40.**

3. 5 People can sit in a car. How many people can sit in 9 such cars ?

Answer : Number of People sitting in 1 car = 5

Number of People sitting in 9 cars = 9 x 5 = 45

4. There are 27 candles .Put them equally in 3 boxes.

How many candles will be in each box?

Answer :

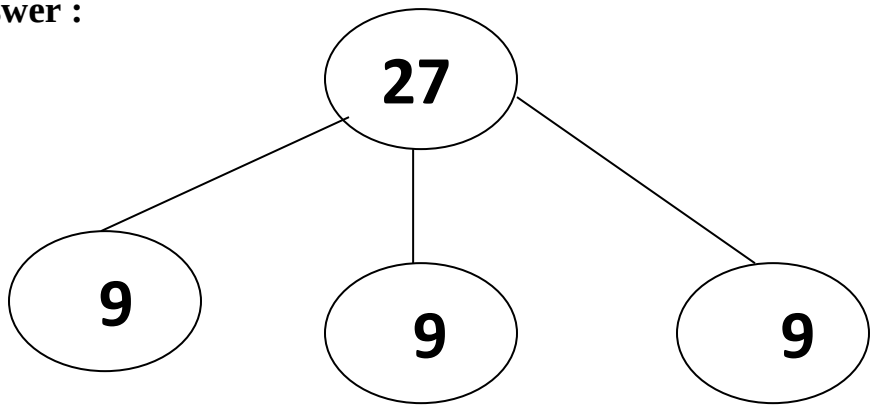

9 Candles in each box

IV. Multiplication:

1. 13 x 3	2. 26 x 2	3. 53 x 4	4. 82 x 2	5. 44 x6
39	52	212	164	264

6. 58 x 2	7. 38 x 4	8.36 x 3	9. 54 x 6
116	152	78	324

V. Simple Division

Make equal parts

1. 10 ÷ 2

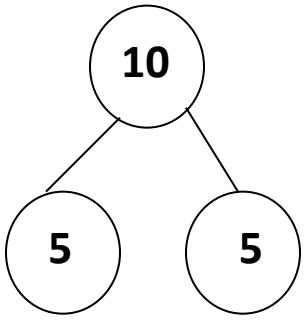

2. 9 ÷ 3

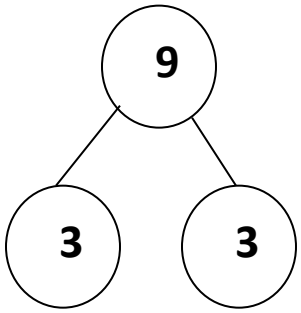

3.12 ÷ 4

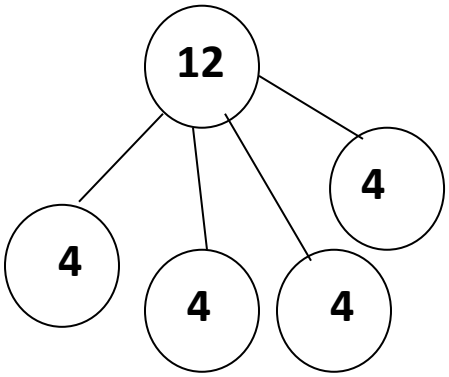

4. 100 ÷ 2

