MOTHER TERESA PUBLIC SCHOOL

HONGASANDRA , BANGALORE -560068

LESSON BASED STUDY MATERIAL / ASSESSMENT (LBA - 2026- 2027)

CLASS:3

SUBJECT :Mathematics

PART 2

Ref : DEPARTMENT OF STATE RESEARCH & TRAINING CENTRE

INDEX

SN	Upload Date	Title	Approved on/ by	Remarks
1 2	07/11/26 07/11/26	Fair share House of hundreds ll		

Lesson – 8
Fair Share

I. Write the parts of whole

1. Whole – Full circle
2.Half – 1/2 of a circle
3.Quarters – 1/4 of a circle
4.One-Eighth – 1/8 of a circle

II. Write half and double for the following.

1)4 marbles are **half** of 8 marbles. (half/double)
2)10 marbles are **double** of 5 marbles. (half/double)
3)12 marbles are **double** of 6 marbles. (half/double)
4)14 marbles are **double** of 7 marbles. (half/double)
5)8 marbles are **half** of 16 marbles. (half/double)

III Tick the Correct Word

1)Riya has coloured 4 out of 8 flowers.
a) Half ✔ □
b) Quarters

2)Aman has eat 2 chocolates out of 8 chocolates.
a) Half
b) Quarters ✔ □

3)Meena has used 4 books out of 16 books.
a) Half
b) Quarters ✔ □

4)Ravi gave 5 biscuits to his brother out odf 10 biscuits.
a) Half ✔ □
b) Quarter

IV.Tick the shapes where half of the whole is shaded

1.

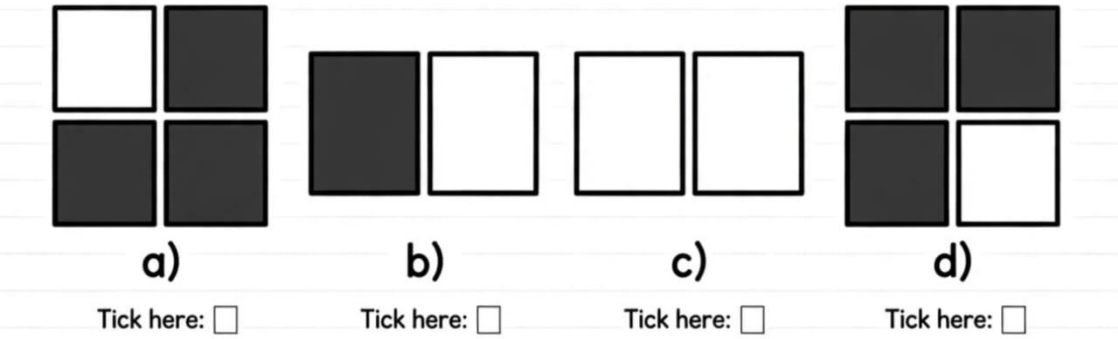

2.

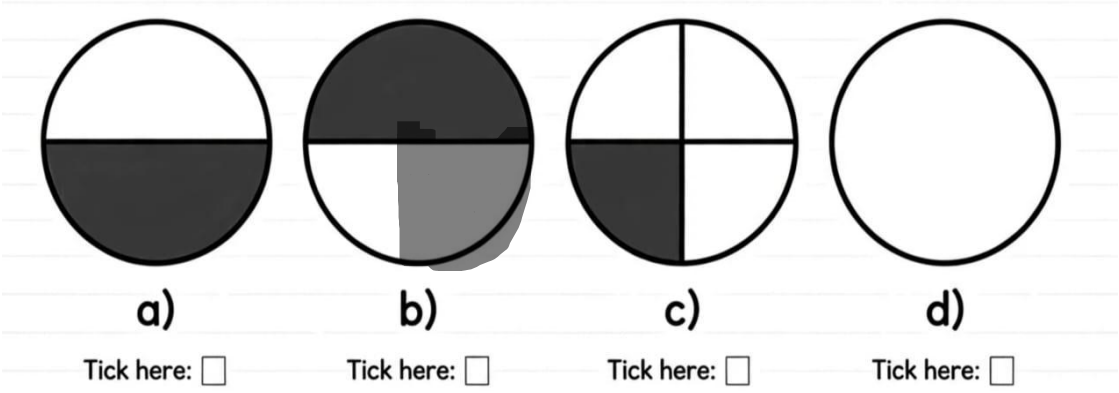

V.Colour the Following

1. **½ half of the ball**

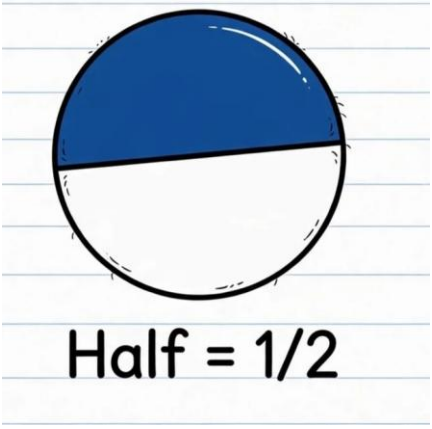

2. ¼ Quarter of the pizza

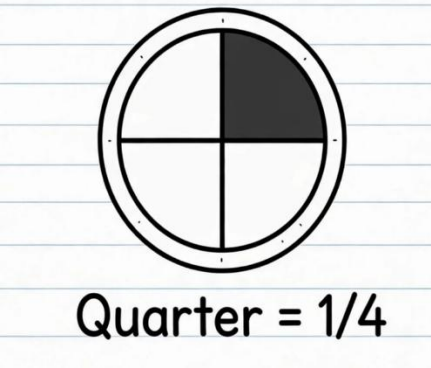

Lesson 9
House of hundreds -ll

I.Draw tiles for the following numbers

Hundred  **Tens**  **Ones** 

1. 832 = 8 Hundreds • 3 Tens • 2 Ones (800+30+2)

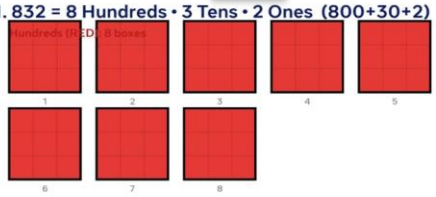

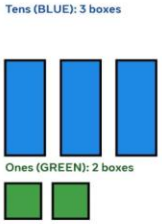

2. 504 = 5 Hundreds • 0 Tens • 4 Ones (500+0+4)

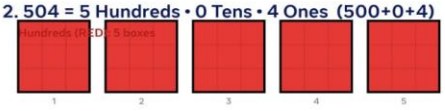



3. 620 = 6 Hundreds • 2 Tens • 0 Ones (600+20+0)





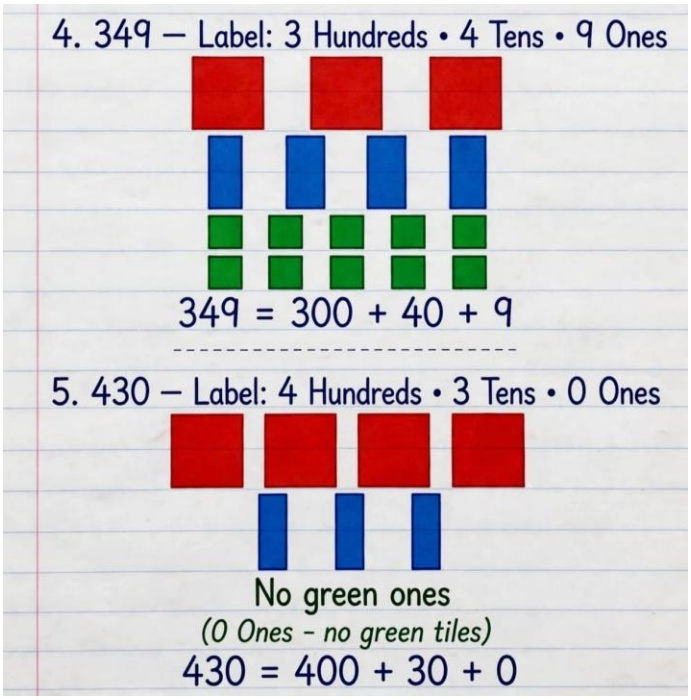

II Skip and solve the problem

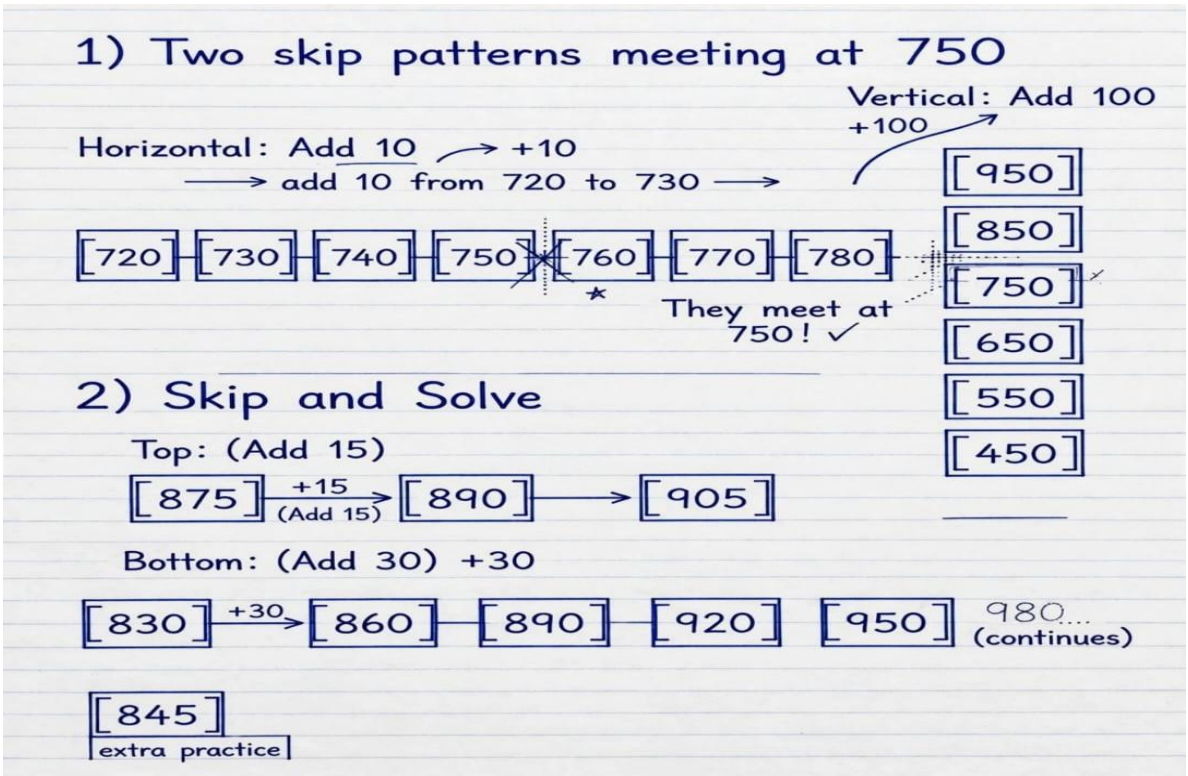

III.Follow the numbers and patterns and Answer the following

1. Look at the hundreds: 100, 200, 300 Can you find all the hundreds.
Ans 400, 500, 600, 700, 800, 900

2. Some numbers are special like 789, 345 and 123, Can You find some more?
Ans 678, 567, 456, 234

3) numbers that repeat just like a twin or triplet digits Such as, 111, 22, 3333. Now You find some more numbers?
Ans 44, 555, 66, 777, 88

4) Write the numbers that looks the same from left to right and right to left
Eg: 353, 868
Ans 191, 262, 595, 676, 373,

5) Bharath likes numbers with Zeroes he knows numbers like 210, 404 and 800. Write more such numbers?
Ans 900, 110, 506, 803, 700

IV. MATCH THE FOLLOWING

1. I have 2 Zeroes as digits and I am very close to 99	150(4)
2. I have 3 hundreds 6 tens and 7 ones	425(5)
3. I have Zero tens and Zero ones	367(2)
4. I am Century (100) + half Century (50)	400 (3)
5. I come between 400 and 450 and I have 5 as a digit	100 (1)

V.Write the numbers related to the number in the center

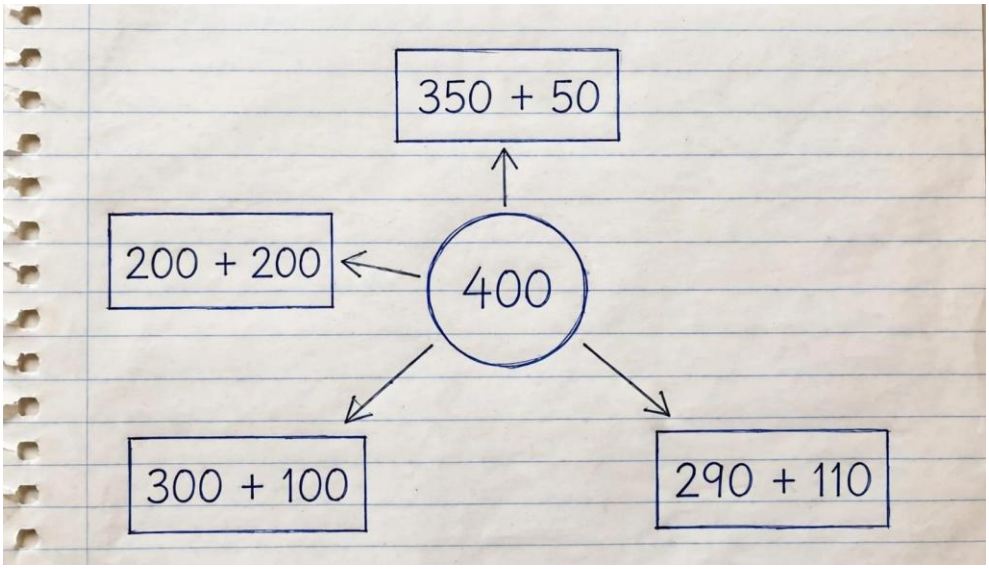
350 + 50
200 + 200
400
300 + 100
290 + 110

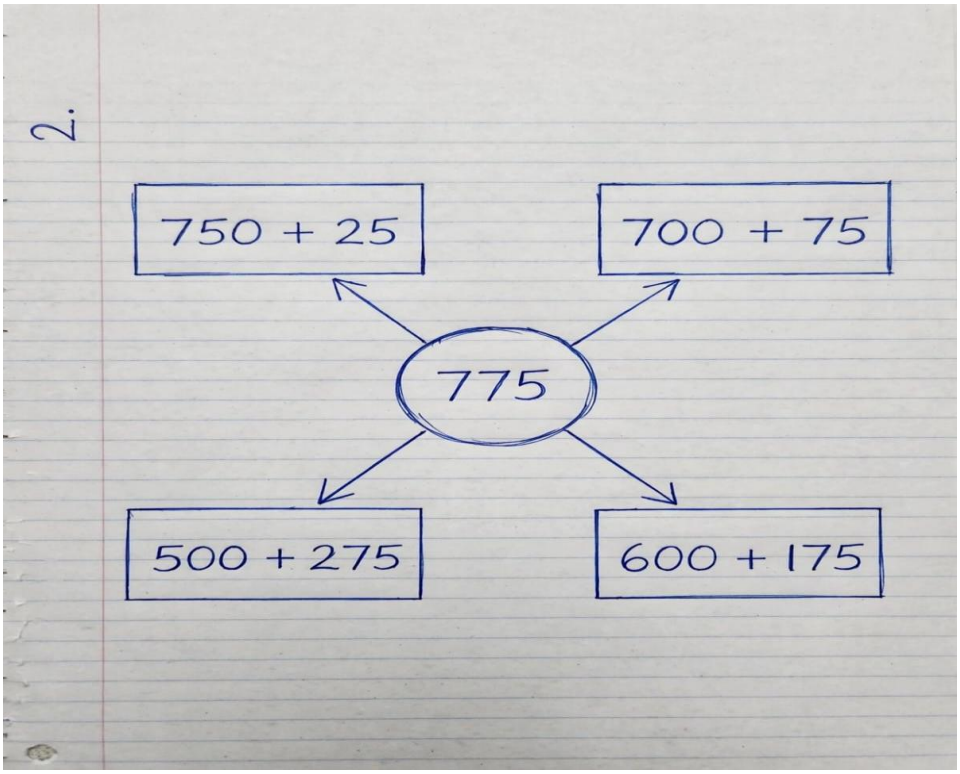
2.
750 + 25
700 + 75
775
500 + 275
600 + 175